Math

1st GRADE

1

1, 2, 3, 4, 5, 6,

8, 9, 10, ..., 100

2

education.com

Table of Contents

First Grade Math

Missing Numbers: Counting Odd Numbers
Hippity Hop
Ice Breaker
Math Counting 1-50
Math Counting 50-100
Superstar Addition
Dino Addition
Coloring Addition
Math Maze
Find the Sum
Coloring Subtraction: Sky Scene
Coloring Subtraction Underwater Scene
Problem Solving
Simple Subtraction
Identifying 1/2
Fraction Action: 1/2
Coloring 1/2
Find 1/2
Identifying 1/3
Fraction Action: 1/3
Coloring 1/3
Identifying 1/4
Fraction Action: 1/4
Coloring 1/4
Showtime!
Recognizing Day & Night #1
Recognizing Day & Night #2

Certificate of Completion

Want more workbooks? Join Education.com Plus to save time and money.
http://www.education.com/education-plus/

Copyright © 2012 Education.com. All Rights Reserved

Missing Numbers
Counting Odd Numbers

Fill in the missing numbers in the chart.

	2		4		6		8		10
	12		14		16		18		20
	22		24		26		28		30
	32		34		36		38		40
	42		44		46		48		50
	52		54		56		58		60
	62		64		66		68		70
	72		74		76		78		80
	82		84		86		88		90
	92		94		96		98		100

Copyright 2008-2009 Education.com

Created by : education.com
www.education.com/worksheets

Hippity Hop

Help Freddy the Frog fill in the missing numbers on the lily pads.



1		3		5		7		9	
11		13		15		17		19	
21		23		25		27		29	
31		33		35		37		39	
41		43		45		47		49	
51		53		55		57		59	
61		63		65		67		69	
71		73		75		77		79	
81		83		85		87		89	
91		93		95		97		99	

Copyright 2008-2009 Education.com

Created by : education.com
www.education.com/worksheets

Ice Breaker

Help Petey the Penguin fill in the missing numbers on the icebergs.



1	2	3	4		6	7	8	9	
11	12	13	14		16	17	18	19	
21	22	23	24		26	27	28	29	
31	32	33	34		36	37	38	39	
41	42	43	44		46	47	48	49	
51	52	53	54		56	57	58	59	
61	62	63	64		66	67	68	69	
71	72	73	74		76	77	78	79	
81	82	83	84		86	87	88	89	
91	92	93	94		96	97	98	99	

Copyright 2008-2009 Education.com

Created by : education.com
www.education.com/worksheets

1st Grade Math

Counting

Count from 1 to 50 by filling in the missing numbers in the presents below!

1	2	3					
7		9	10			13	14
15			18		20	21	
		25	26	27			30
31		33				37	
39			42		44		
47							

Great job!



Copyright 2010-2011 Education.com

Created by : education.com
www.education.com/worksheets

1st Grade Math

Counting

Count from 50 to 100 by filling in the missing numbers in the planets below!

Start here!

50	51					56
			60	61	62	
	66		68			71
73		75				80
		83		85		
89				93		96
		99				

Terrific!

Copyright 2010-2011 Education.com

Created by : education.com
www.education.com/worksheets

Superstar

Count the stars in each group. Write the number in the box. Write the sum in the last box.



Copyright 2008-2009 Education.com

Created by : education.com
www.education.com/worksheets

Grade 1

Dino Addition!

Your dynamite math skills will help you add these numbers!

1. 5 + 3 = ____
2. 4 + 3 = ____
3. 6 + 2 = ____
4. 4 + 4 = ____
5. 2 + 2 = ____
6. 1 + 8 = ____
7. 3 + 5 = ____
8. 2 + 5 = ____
9. 2 + 4 = ____
10. 2 + 7 = ____
11. 2 + 3 = ____
12. 2 + 1 = ____

education.com Copyright 2008-2009 Education.com

Coloring Addition

Find the answer to each problem , then use the numbers to color the picture.

7+2 = _____ black

3+2 = _____ blue

5+1 = _____ orange

6+1 = _____ yellow

2+2 = _____ green

3+0 = _____ red



Copyright 2008-2009 Education.com

Created by : education.com
www.education.com/worksheets

Math Maze

Connect the problem with the answer

tip: use a different colored pencil for each maze to keep track!

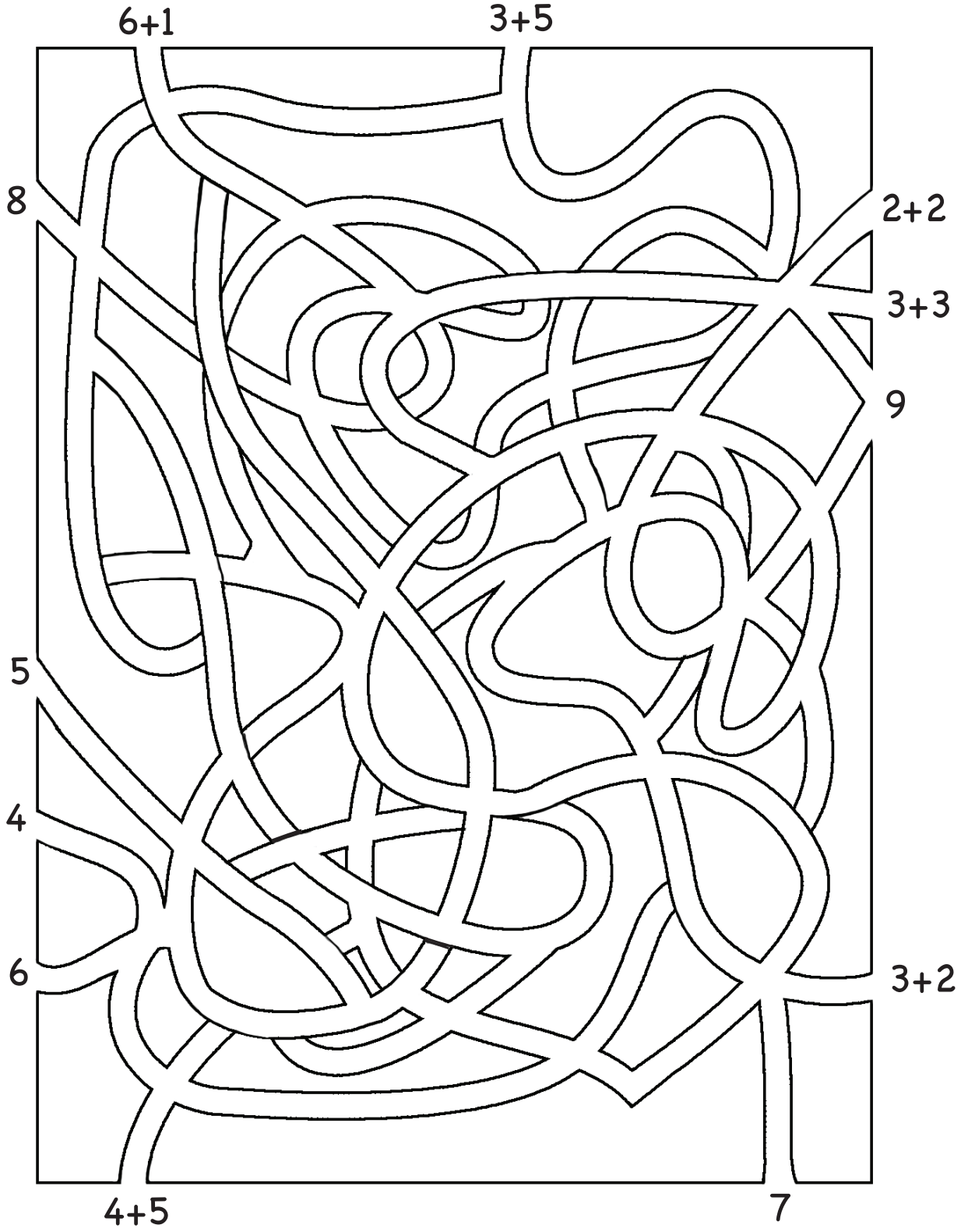

education.com Copyright © 2011-2012 by Education.com

Find the Sum

Add to find the answer to each problem. Then use the letters next to each equation to find out the answer to the question.

6 + 3 = ___ C	2 + 1 = ___ A	4 + 4 = ___ R	8 + 2 = ___ K	3 + 2 = ___ P
1 + 1 = ___ A	6 + 1 = ___ H	8 + 4 = ___ S	7 + 2 = ___ T	8 + 5 = ___ W
2 + 2 = ___ C	6 + 0 = ___ I	3 + 8 = ___ M	5 + 2 = ___ O	7 + 1 = ___ F

Which is the largest US state?

___	___	___	___	___	___
3	6	3	12	10	2

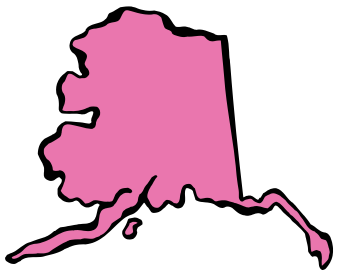

Created by : education.com
www.education.com/worksheets

Copyright 2008-2009 Education.com

Coloring Subtraction

Find the answer to each problem, then use the numbers to color the picture.

8 - 1 = _____ orange

7 - 6 = _____ gray

9 - 4 = _____ blue

6 - 6 = _____ red

3 - 1 = _____ yellow

8 - 5 = _____ black

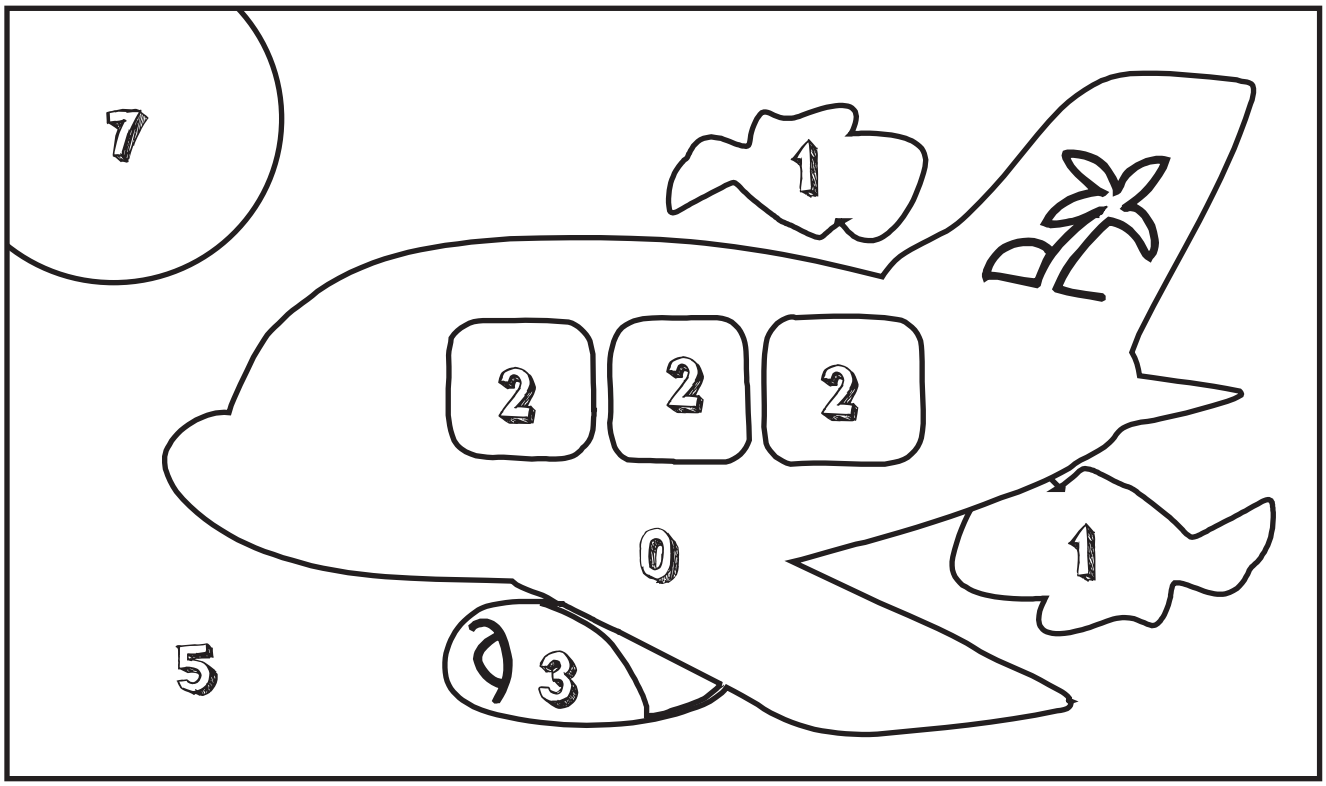

Copyright 2008-2009 Education.com

Created by : education.com
www.education.com/worksheets

Coloring Subtraction

Find the answer to each problem, then use the numbers to color the picture.

8 - 3 = _____ blue

9 - 5 = _____ purple

6 - 5 = _____ brown

7 - 1 = _____ yellow

3 - 3 = _____ red

8 - 6 = _____ orange

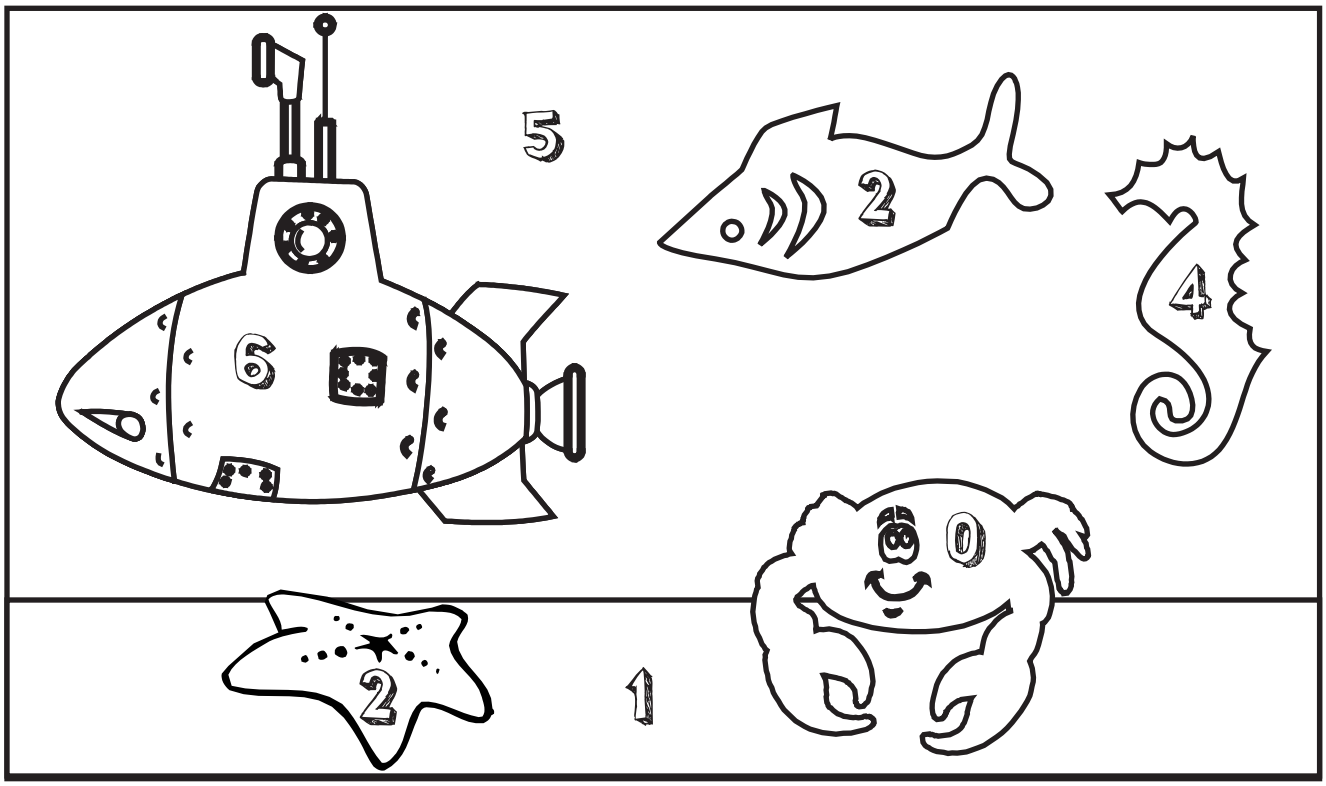

Copyright 2008-2009 Education.com

Created by : education.com
www.education.com/worksheets

Problem Solving

Read each story problem and solve.



Jerry picked 7 apples.
He ate 2 of them.
How many does he have left?

_____ apples

2 squirrels are black.
3 squirrels are gray.
How many squirrels are there in all?

_____ squirrels

There are 5 butterflies.
3 flew away.
How many butterflies are left?

_____ butterflies

Created by : education.com
www.education.com/worksheets

Copyright 2008-2009 Education.com

SIMPLE SUBTRACTION

Subtract the numbers inside the pear and circle the ones that match up to the number on the leaf.

3

4-1
3-2
5-2
6-1

6

7-1
8-2
4-3
9-7

4

8-3
6-2
3-1
8-4

2

4-2
3-1
5-1
9-7

5

6-1
9-2
8-3
7-2

7

6-4
9-2
8-1
5-2

Copyright 2010-2011 Education.com

created by: education.com
www.education.com/worksheets

Identifying 1/2

Look at the objects below.
Circle the shapes that have 1/2 colored in.



Copyright 2008-2009 Education.com

Created by : education.com
www.education.com/worksheets

FRACTION ACTION!

Circle the shapes below that show **1/2**.

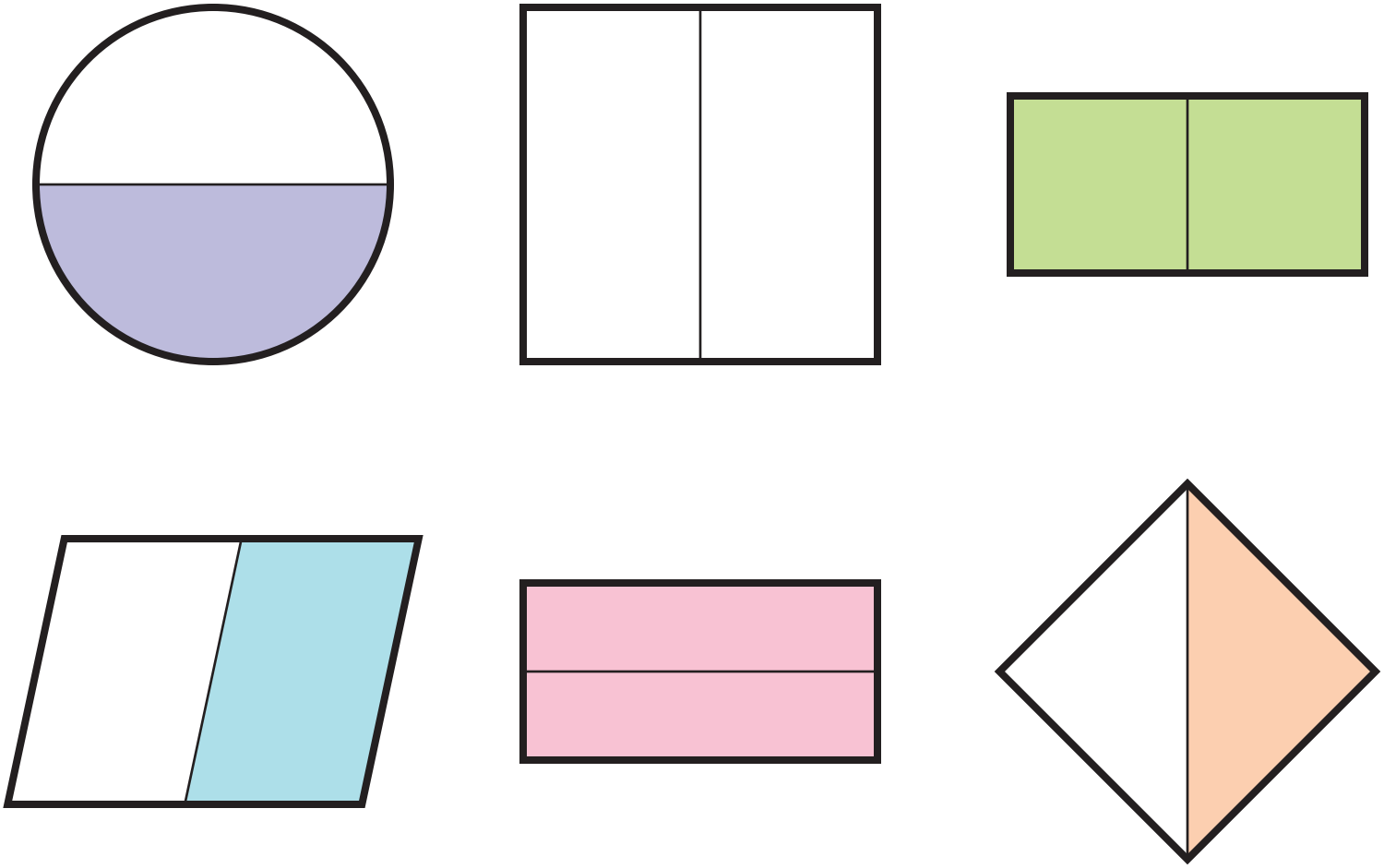

Color one part of each shape below to make **1/2**.

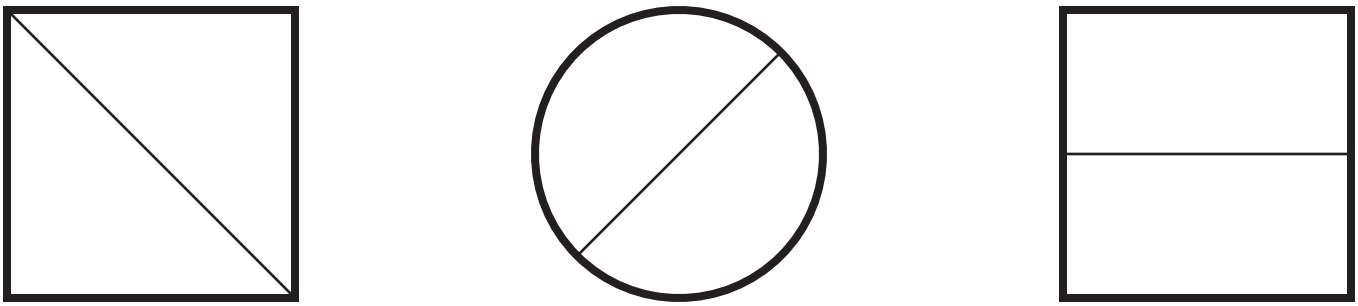

education.com Copyright © 2011-2012 by Education.com

Coloring 1/2

Color in the fraction of each shape written below it.

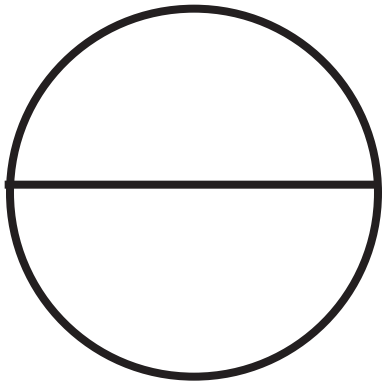

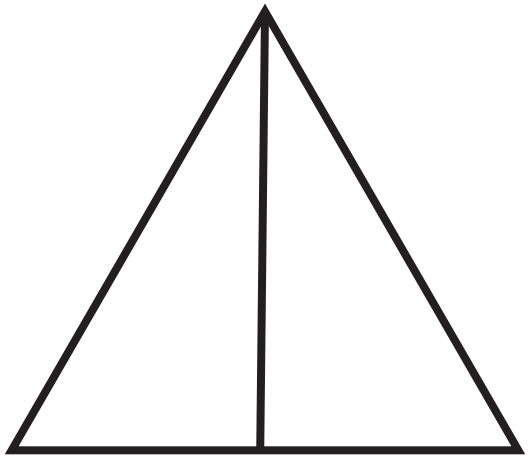







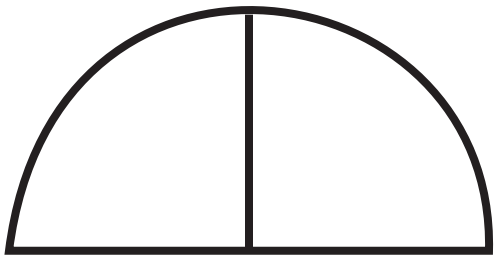

Copyright 2008-2009 Education.com

Created by : education.com
www.education.com/worksheets

Find $\frac{1}{2}$

Circle $\frac{1}{2}$ of each group of items. Note: One of them does not split in half evenly. Do you know which one?

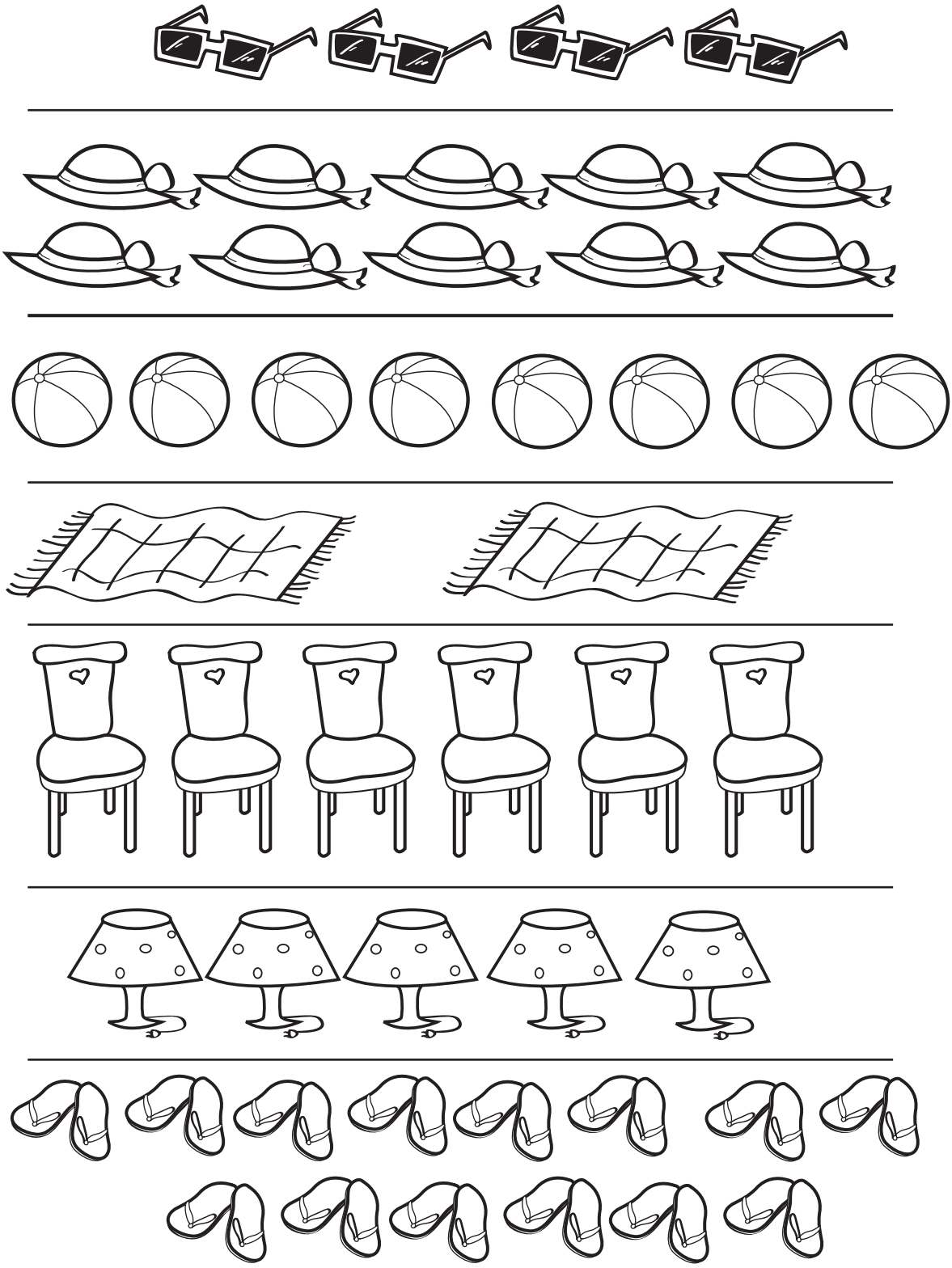

education.com Copyright © 2009-2010 by Education.com

Identifying 1/3

Look at the objects below.

Circle the shapes that have 1/3 colored in.







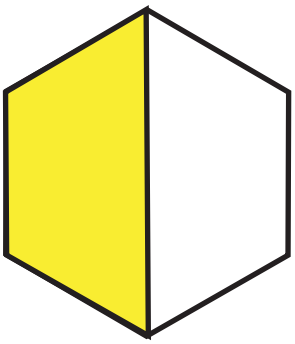

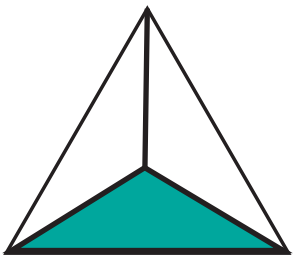



Copyright 2008-2009 Education.com

Created by : education.com
www.education.com/worksheets

FRACTION ACTION!

Circle the shapes below that show **1/3**.

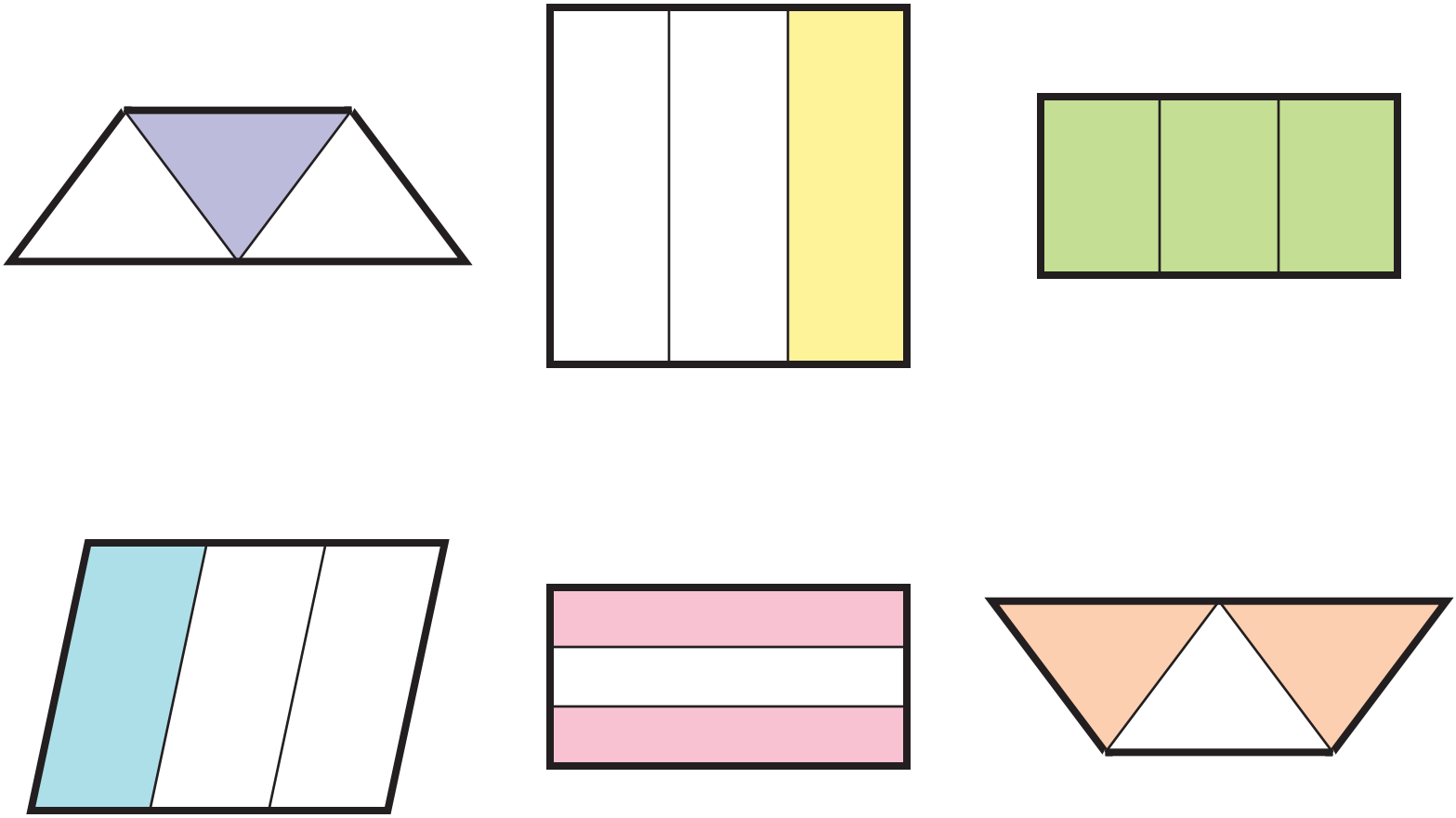

Color one part of each shape below to make **1/3**.

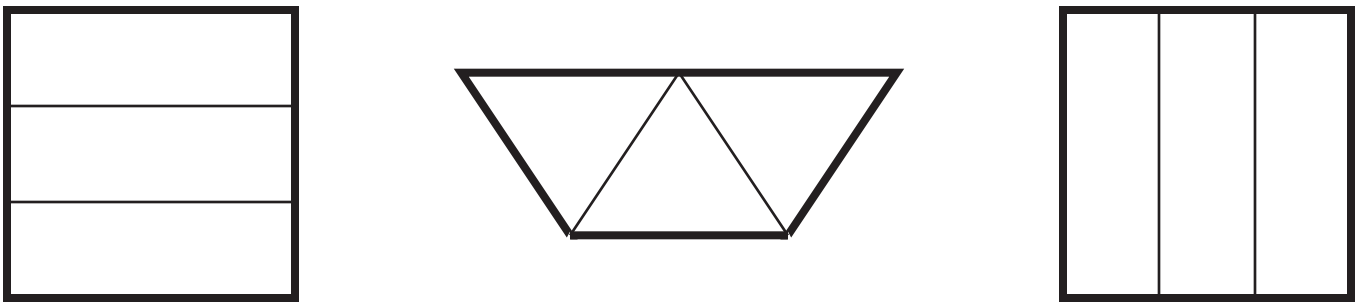

education.com Copyright © 2011-2012 by Education.com

Coloring 1/3

Color in the fraction of each shape written below it.

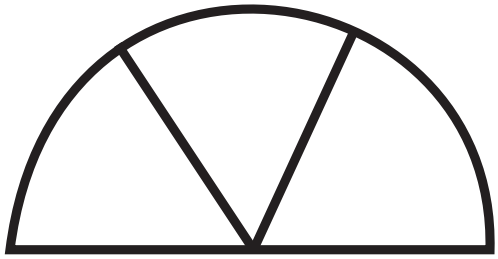





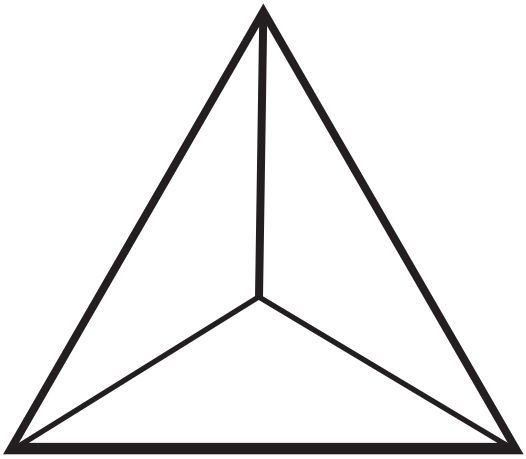

Created by : education.com
www.education.com/worksheets

Copyright 2008-2009 Education.com

Identifying 1/4

Look at the objects below.
Circle the shapes that are 1/4 colored in.



Copyright 2008-2009 Education.com

Created by : education.com
www.education.com/worksheets

FRACTION ACTION!

Circle the shapes below that show **1/4**.

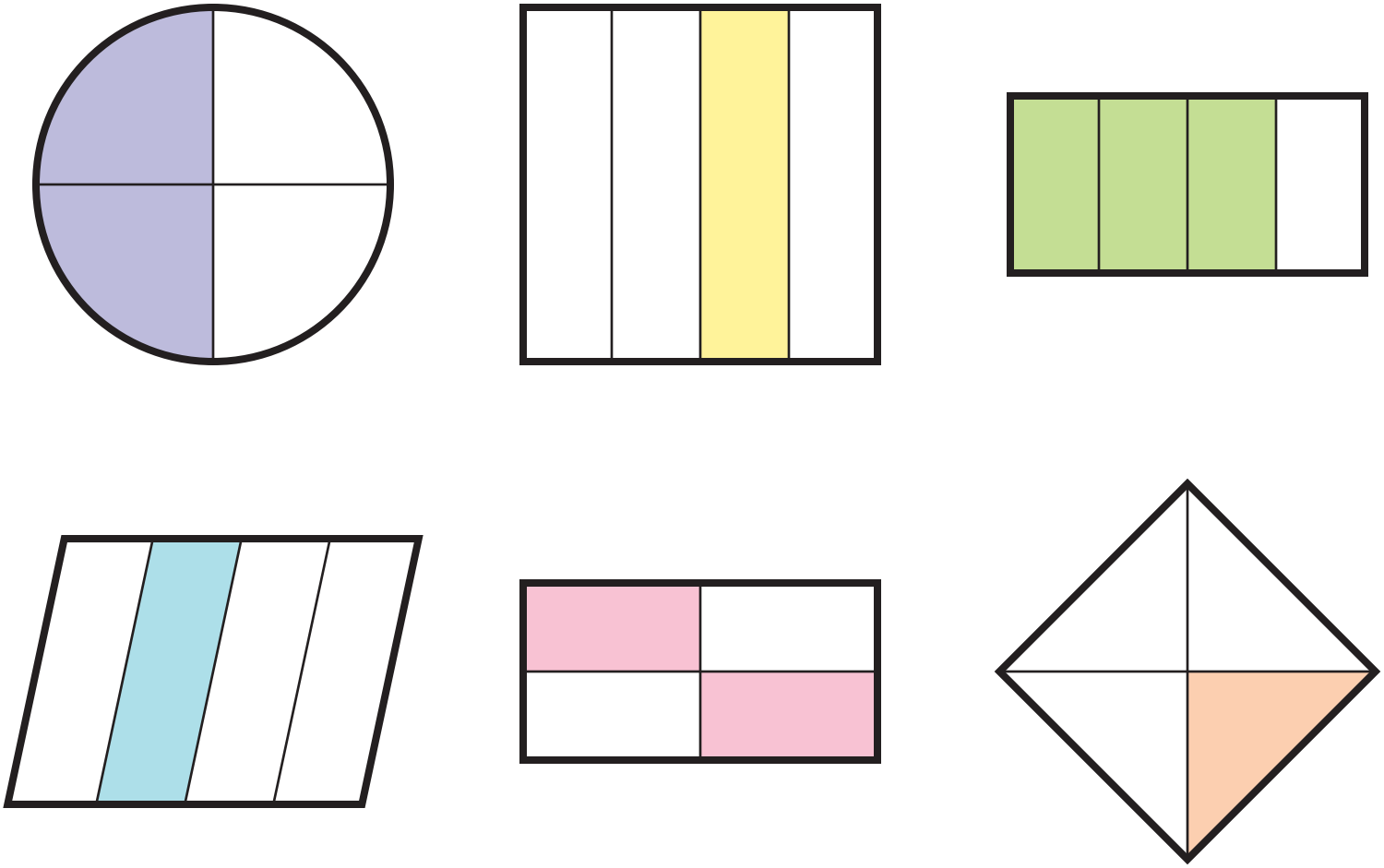

Color one part of each shape below to make **1/4**.



education.com Copyright © 2011-2012 by Education.com

Coloring 1/4

Color in the fraction of each shape written below it.



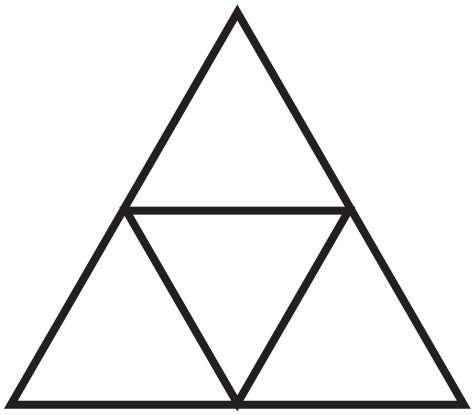



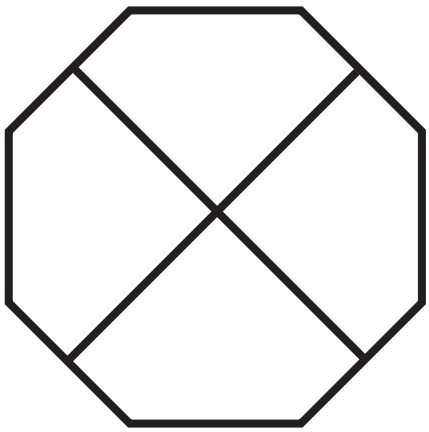



Created by : education.com
www.education.com/worksheets

Copyright 2008-2009 Education.com

Showtime!

Draw in the hands of the clock to show the time written below it.

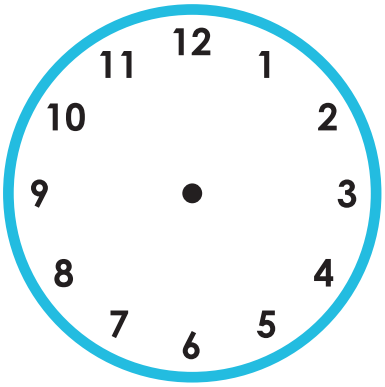

3:00

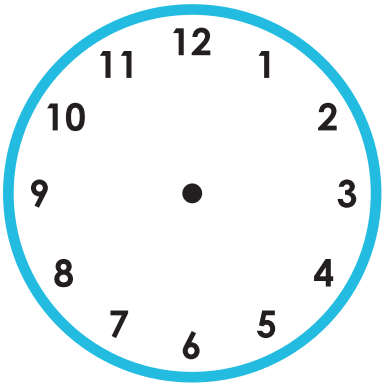

7:00

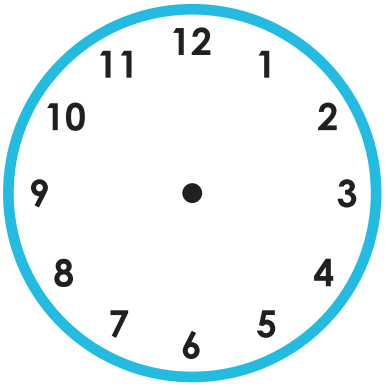

10:00

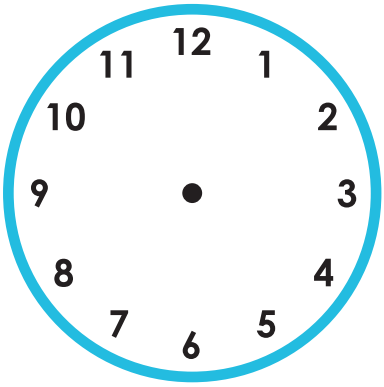

5:00

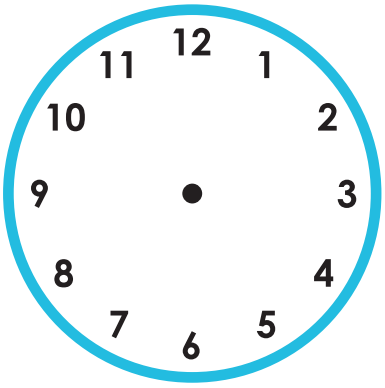

8:00

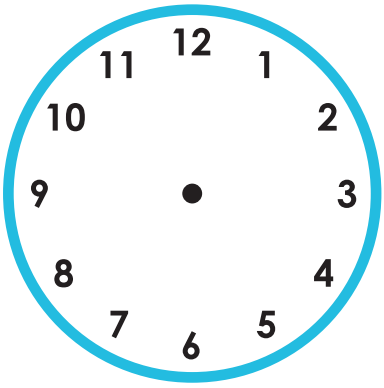

2:00

Copyright 2008-2009 Education.com

Created by : education.com
www.education.com/worksheets

RECOGNIZING DAY & NIGHT

There are hours of the day that you have light and dark. When it is dark it is **nighttime**. When it is light it is **daytime**. When the sun sets it is called the **sunset** and when the sun rises it is called the **sunrise**.

DIRECTIONS: Circle the time of day that best matches the time on the clock!

P.M.

NIGHT

SUNRISE

DAY

SUNSET

P.M.

NIGHT

SUNRISE

DAY

SUNSET

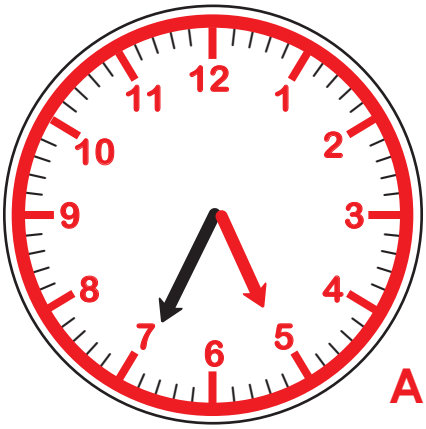

A.M.

NIGHT



SUNRISE

DAY

SUNSET

education.com Copyright © 2011-2012 by Education.com

RECOGNIZING DAY & NIGHT

There are hours of the day that you have light and dark. When it is dark it is **nighttime**. When it is light it is **daytime**. When the sun sets it is called the **sunset** and when the sun rises it is called the **sunrise**.

DIRECTIONS: Circle the time of day that best matches the time on the clock!

A.M.

NIGHT

SUNRISE

DAY

SUNSET

P.M.

NIGHT

SUNRISE

DAY

SUNSET

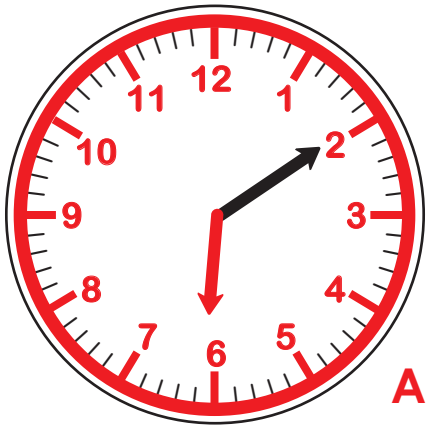

A.M.

NIGHT

SUNRISE

DAY

SUNSET

education.com Copyright © 2011-2012 by Education.com

Great job!

_____

is an Education.com math superstar

education.com