Name : _____ Score : _____

Identifying Graphs

MS1

Choose the correct graph that best describes the solution for each inequality.

1) $17x + 16 < 5x + 4$

a)

b) 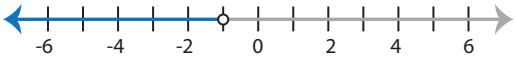

c) 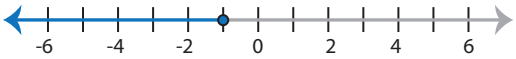

d)

2) $4 \geq \frac{2x + 6}{12}$

a) 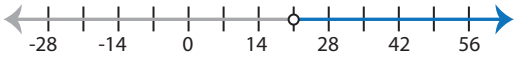

b) 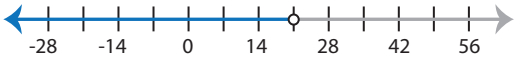

c) 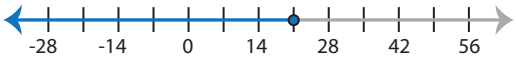

d) 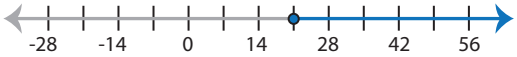

3) $2x - 5 \leq \frac{8x}{3} - 9$

a) 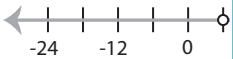

b) 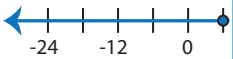

c) 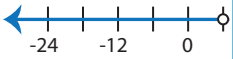

d) 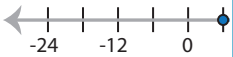

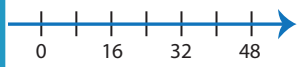

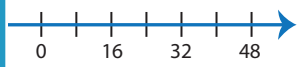

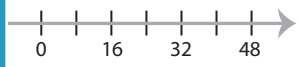

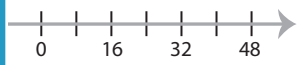

5) $9x - 14 > 15x + 2$

a) 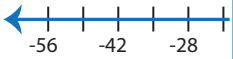

b) 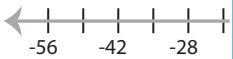

c) 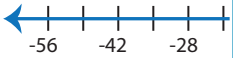

d) 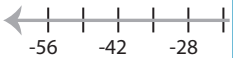

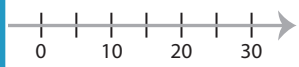

7) $-4 \leq \frac{3x - 2}{8}$

a) 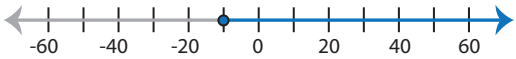

b)

c) 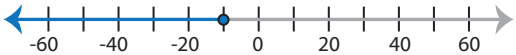

d) 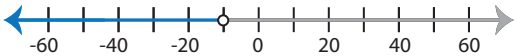

8) $3(7x - 24) \geq 13x$

a) 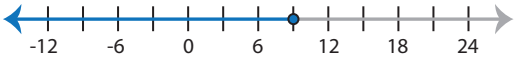

b) 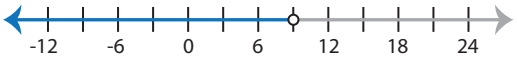

c) 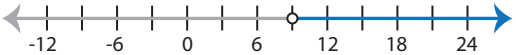

d) 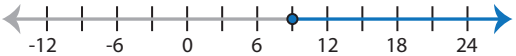

PREVIEW

Access the largest collection of worksheets for just $19.95 per year!

Members, please log in to download this worksheet.

Log in

Not a member? Please sign up to gain complete access.

Sign up

www.mathworksheets4kids.com

Name : _____ **Answer key** Score : _____

Identifying Graphs

MS1

Choose the correct graph that best describes the solution for each inequality.

1) $17x + 16 < 5x + 4$

a)

b) 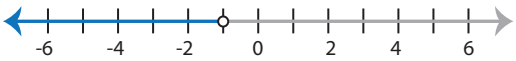

c) 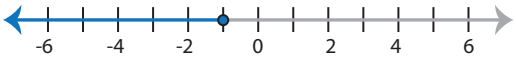

d)

2) $4 \geq \frac{2x + 6}{12}$

a) 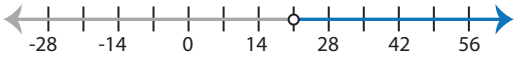

b) 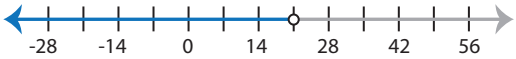

c) 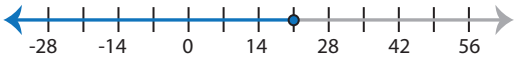

d) 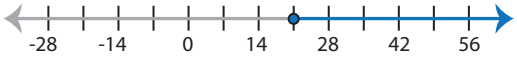

3) $2x - 5 \leq \frac{8x}{3} - 9$

a) 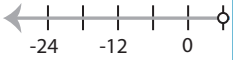

b) 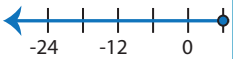

c) 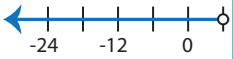

d) 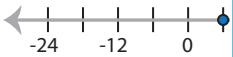

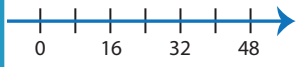

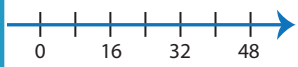

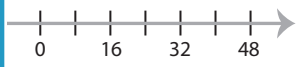

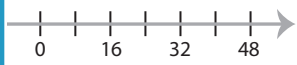

5) $9x - 14 > 15x + 2$

a) 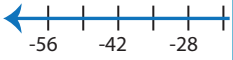

b) 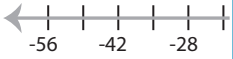

c) 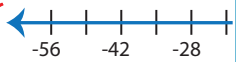

d) 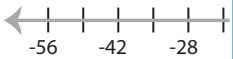

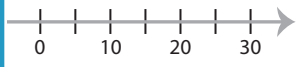

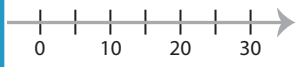

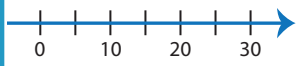

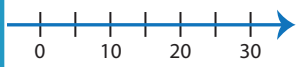

7) $-4 \leq \frac{3x - 2}{8}$

a) 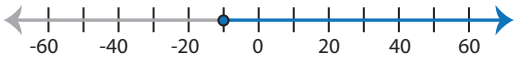

b)

c) 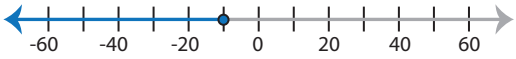

d) 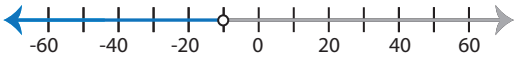

8) $3(7x - 24) \geq 13x$

a) 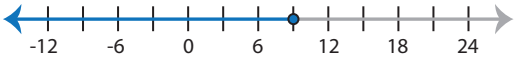

b)

c) 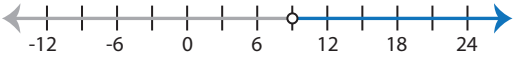

d) 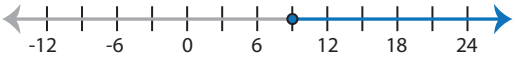

PREVIEW

Access the largest collection of worksheets for just $19.95 per year!

Members, please log in to download this worksheet.

Log in

Not a member? Please sign up to gain complete access.

Sign up

www.mathworksheets4kids.com